Предмет: геометрия
Учитель: Шова Т.А.
Обратная связь: tatiana.sova19@yandex.ru
Работу выслать до 05.05.2023
Тема: Прямоугольные треугольники.

№1

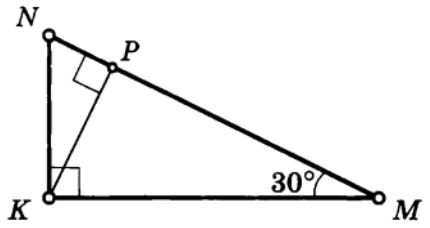

$MN = 36$
MP, PN — ?

№2.

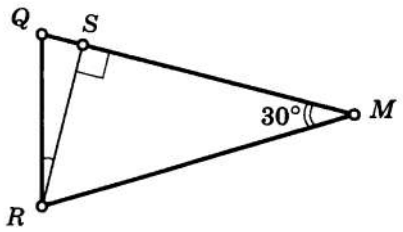

$\angle QRS$ — ?

№3.

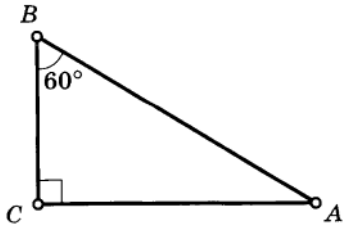

$AB + BC = 12$
AB, BC — ?

№4

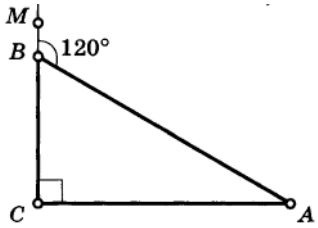

$BC + AB = 36$
AB, BC — ?